# Band Music Theory Placement Test

Stephen Cox

Please Give the Name of each note in either bass clef or Treble Clef

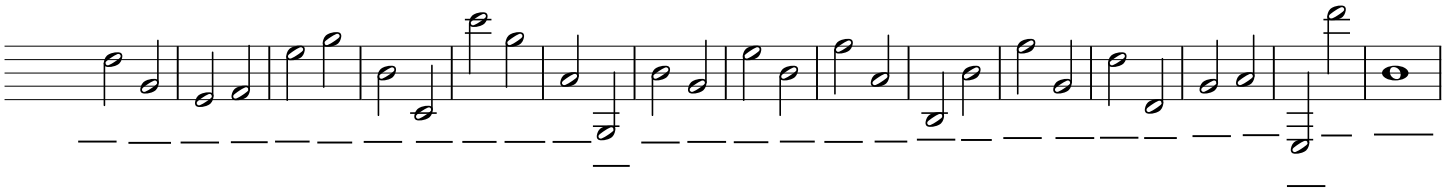

Please Write the type of note (Whole note, Half note, etc) under each note group of notes:



How many beats does each note get in 4/4 time?



The following two lines are rhythm labeling examples:







Please Label the following Rhythms